Function Machines (Add & Subtract) Name:

Determine the rule each function machine is using.

Ex)

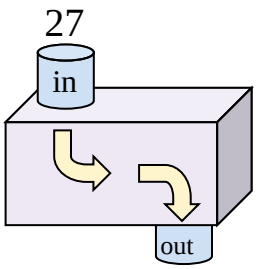

Add 13

1)

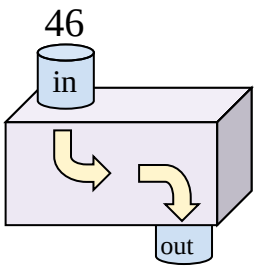

2)

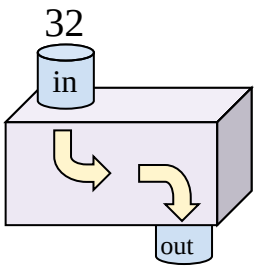

3)

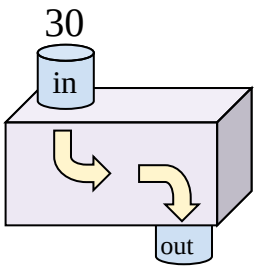

4)

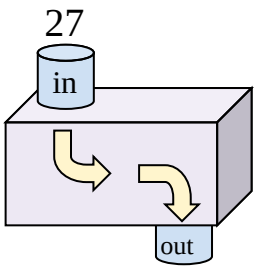

5)

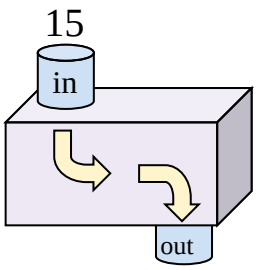

6)

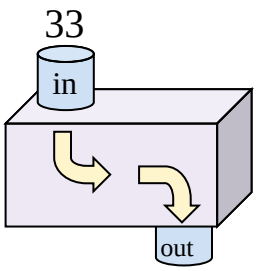

7)

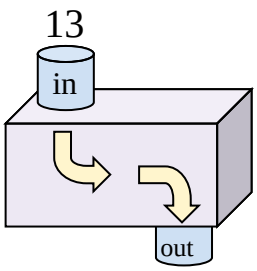

8)

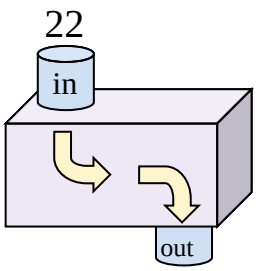

9)

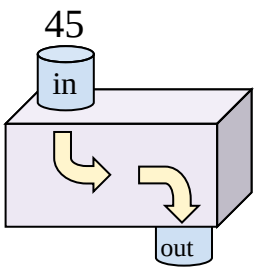

10)

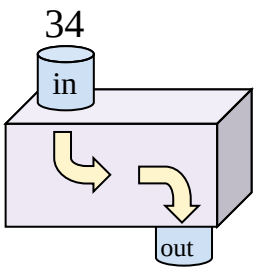

11)

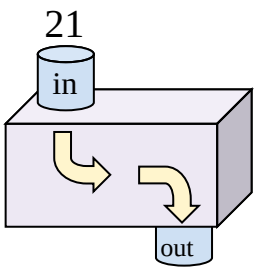

Answers

Ex. Add 13

1. _____
2. _____
3. _____
4. _____
5. _____
6. _____
7. _____
8. _____
9. _____
10. _____
11. _____

Function Machines (Add & Subtract) Name: **Answer Key**

Determine the rule each function machine is using.

Ex)

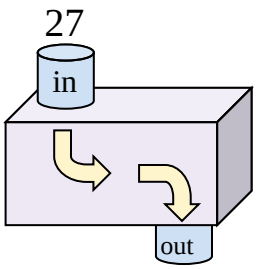

Add 13

1)

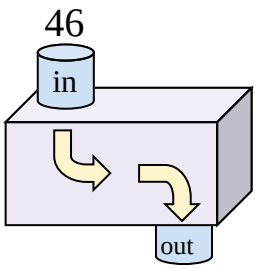

Subtract 28

2)

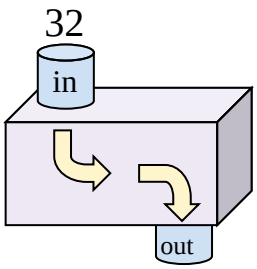

Subtract 13

3)

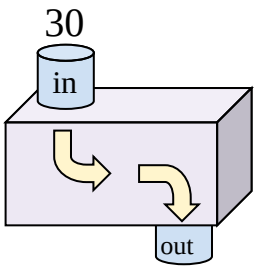

Add 18

4)

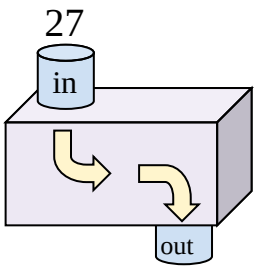

Subtract 8

5)

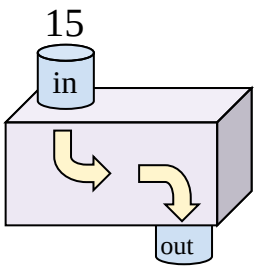

Add 12

6)

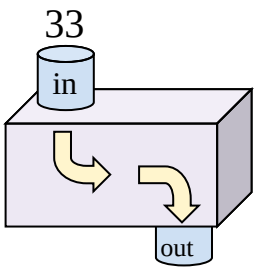

Subtract 9

7)

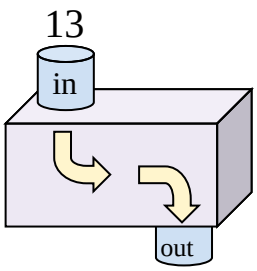

Add 20

8)

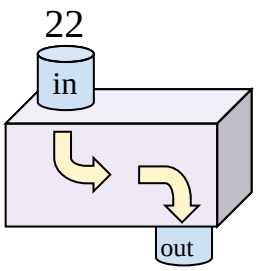

Add 24

9)

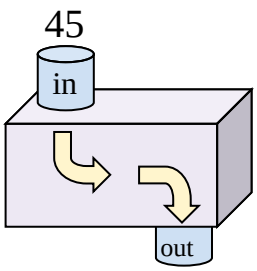

Subtract 35

10)

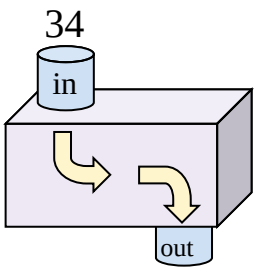

Subtract 16

11)

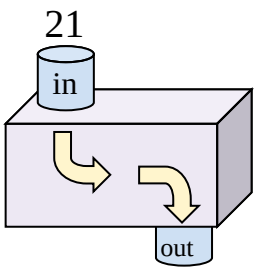

Add 17

Answers

Ex.	Add 13
1.	Subtract 28
2.	Subtract 13
3.	Add 18
4.	Subtract 8
5.	Add 12
6.	Subtract 9
7.	Add 20
8.	Add 24
9.	Subtract 35
10.	Subtract 16
11.	Add 17

1-10	91	82	73	64	55	45	36	27	18	9
11	0									